Name: _____ Period: _____ Group: _____

Introduction to Slope

Graph a Line with a Given Slope

Start from the given point. Then use the RISE and RUN to create a line with the given slope.

① Slope $= \frac{2}{5}$

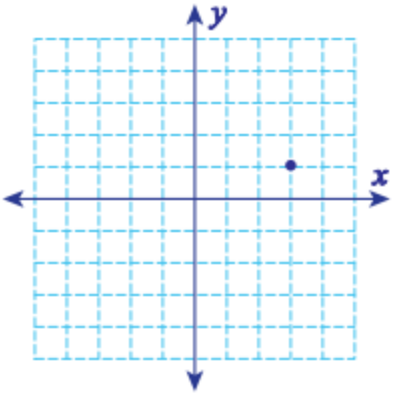

② Slope $= -\frac{4}{7}$

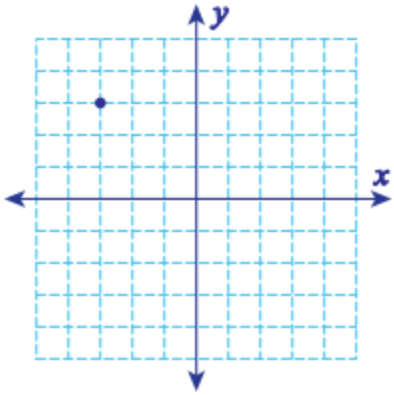

③ Slope $= \frac{1}{6}$

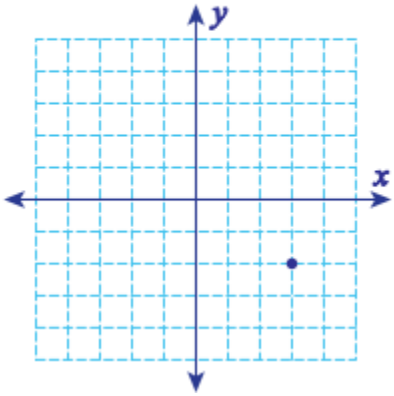

④ Slope $= -\frac{7}{4}$

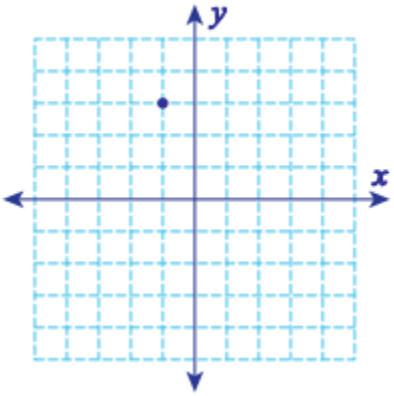

⑤ Slope $= \frac{3}{8}$

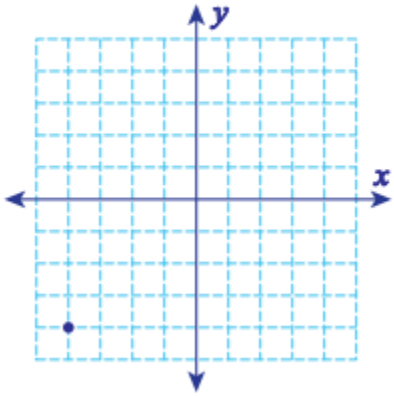

⑥ Slope $= -\frac{5}{2}$

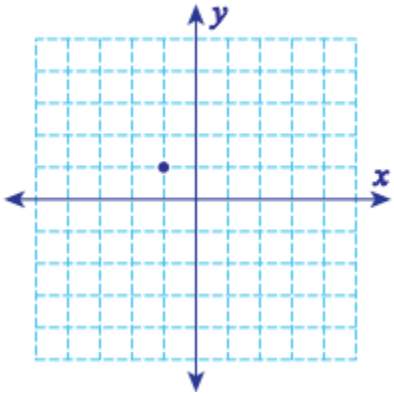

⑦ Slope $= \frac{3}{2}$

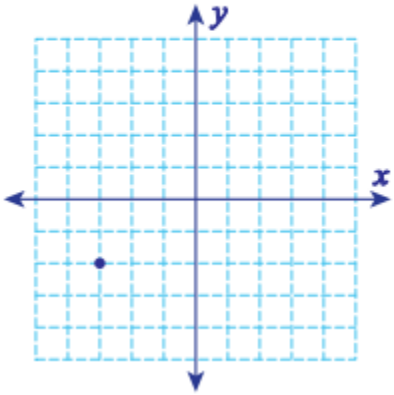

⑧ Slope $= -\frac{8}{5}$

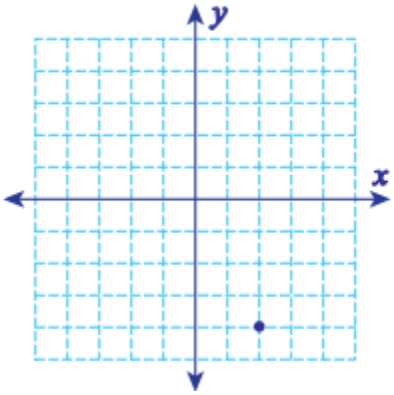
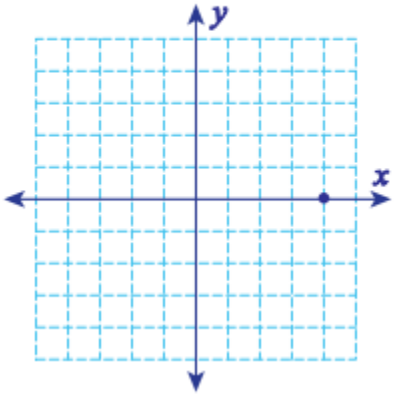
⑨ Slope $= \frac{1}{3}$